NAME _____ DATE _____

COUNTING OBJECTIVES IN GROUPS

Counting objectives in groups by using ones, tens if need.

1. a) How many baskets should the whole sale fruits merchant have to buy, If he needs 685 apples for the shop? (Each basket contain 10 apples).



+ + + + + + + + + + = ___ tens = ____

+ + + + + + + + + + = ___ tens = ____

+ + + + + + + + + + = ___ tens = ____

+ + + + + + + + + + = ___ tens = ____

+ + + + + + + + + + = ___ tens = ____

+ + + + + + + + + + = ___ tens = ____

+ + + + + + + + + + = ___ tens = ___

= ___ tens = ___

The fruits merchants needs ____ apples.

He has to buy ___ baskets of apples.

---

b) How many apples will he have left over after he gets what he needs out of the baskets?

Apples in 69 baskets = ____ + ____ + ____ + ____ + ____ + ____ + ___ + ___

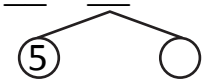

= 100 + 100 + 100 + 100 +100 + 100 + 80 + 5 + ___ = 685 + ___

The fruit seller left with ___ apples.

---

c) How many more apples does he need to have 700 apples?



+ + + + + + + + + + = ___ tens = ____

+ + + + + + + + + + = ___ tens = ____

+ + + + + + + + + + = ___ tens = ____

+ + + + + + + + + + = ___ tens = ____

+ + + + + + + + + + = ___ tens = ____

+ + + + + + + + + + = ___ tens = ____

+ + + + + + + + + + = ___ tens = ____

He fruits seller needs to have ___ baskets for ____ apples.

He already bought ___ baskets.

He needs further ___ baskets = ___ tens = ___ apples.

edubuzzkids.com © 2015. All Rights Reserved.