NAME _____ DATE _____

FINDING VALUES ON METER STRIPS

Each unit length on both number lines is 5 yards.
(Note: Number lines not drawn to scale).

1) Alice measured her belt to be 22 inches long using a yard stick but she did not start her measurement at zero. What might be the two end points of her belt on her meter stick? write a subtraction sentence to match your idea.

Solution:

Each hash mark shows the distance 5 inches.

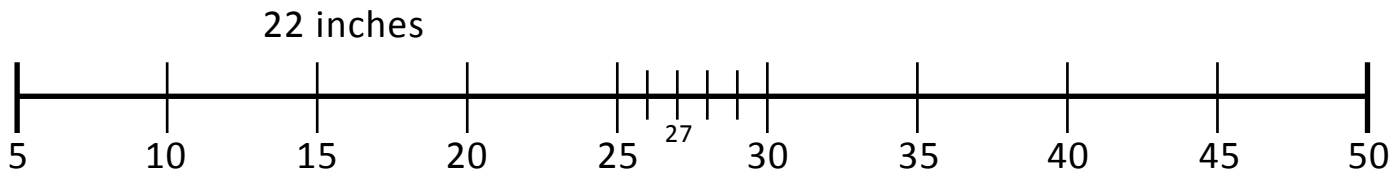

Using tape diagram:

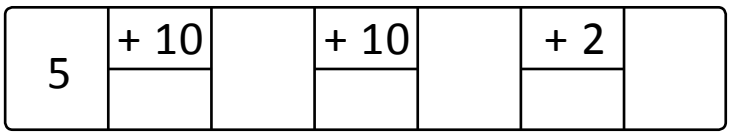

The two end points are (5, 27)

The subtraction sentence is = ___ − ___ = 22.

2) Isaiah ran 100 meters on a 200 meter track. He started running at the 19 meter mark. On what mark did he finish his run?

Solution: **(200 meter track)**

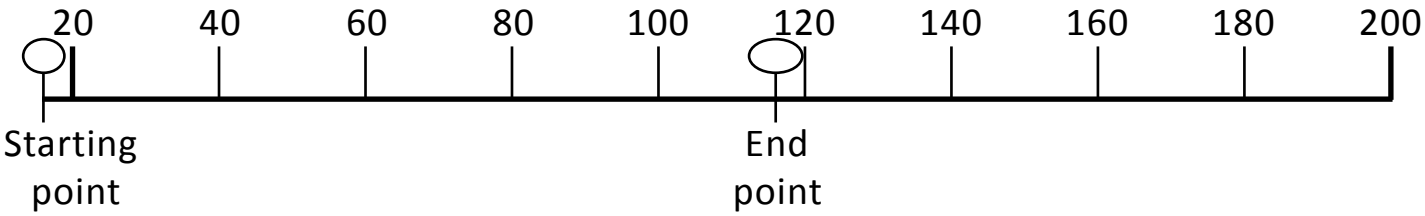

Isaiah ran _____ meters.

Started running at the ___ meters.

Using tape diagram:

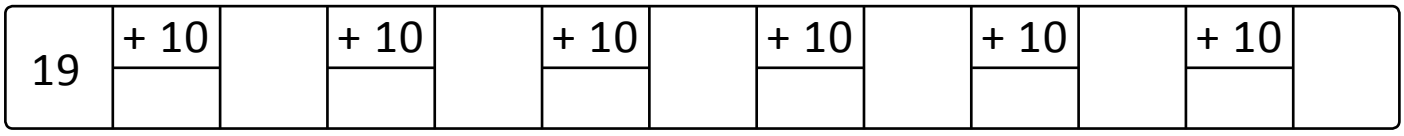

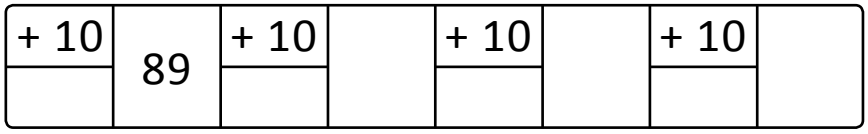

He finished his running on _____ mark.

edubuzzkids.com © 2015. All Rights Reserved.