NAME _____ DATE _____

ADDITION/SUBTRACTION

Problem solving and understanding questions.

1) Mr. Passerini handed out 10 vanilla, 2 chocolate and 8 strawberry ice creams cones. How many ice cream cones did she hand out in all? Show your thinking using words, math drawings or a number sentences.

Using words:

Mr. Passerini handed out

Vanilla ice cream cones = ____.

Chocolate ice cream cones = ___.

Strawberry ice creams cones = ___.

Total ice creams cones = 10 + 2 + 8

= 10 + 10

= ____

By math drawing:

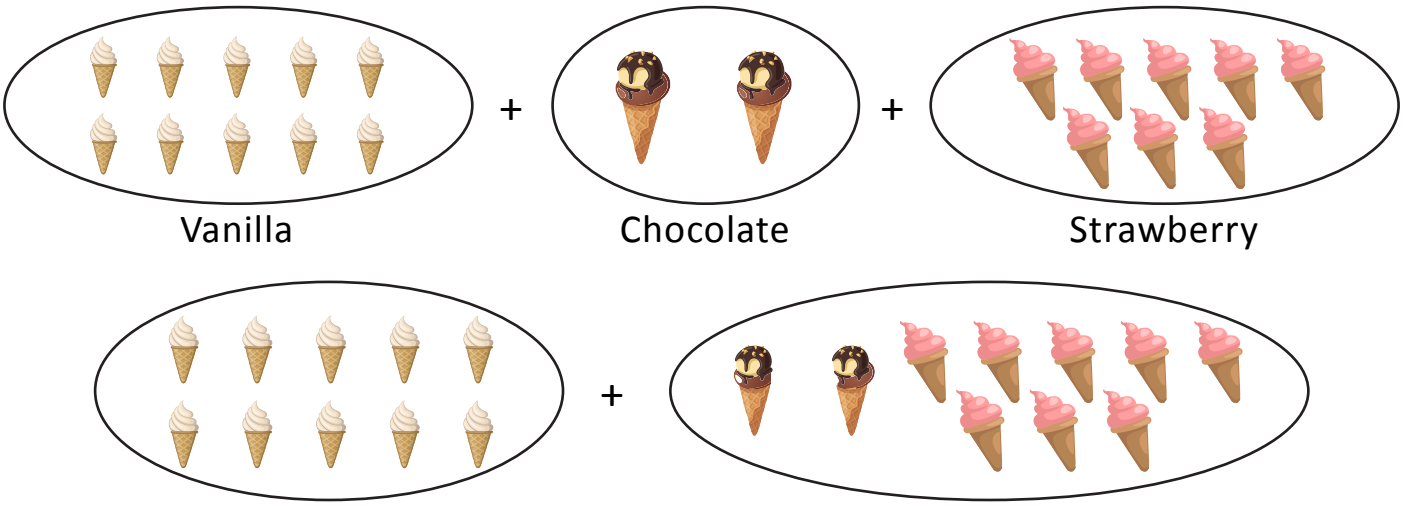

10 + 10 = ____

By using number bond:

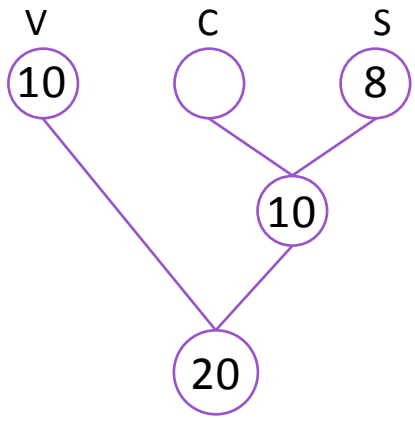

= 10 + 2 + 8

= 10 + ___

= ___



edubuzzkids.com © 2015. All Rights Reserved.